Scrivi le coordinate dei punti

Scrivi le coordinate di ogni punto: prima la x (in orizzontale), poi la y (in verticale).
Esempio: A(3; 5).

Nome: _____ Data: _____

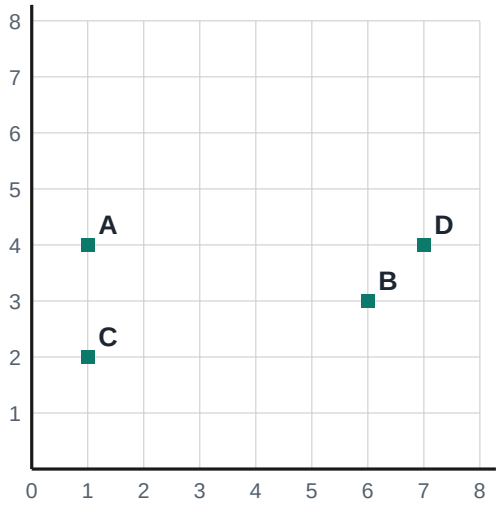

A(_____)
B(_____)
C(_____)
D(_____)

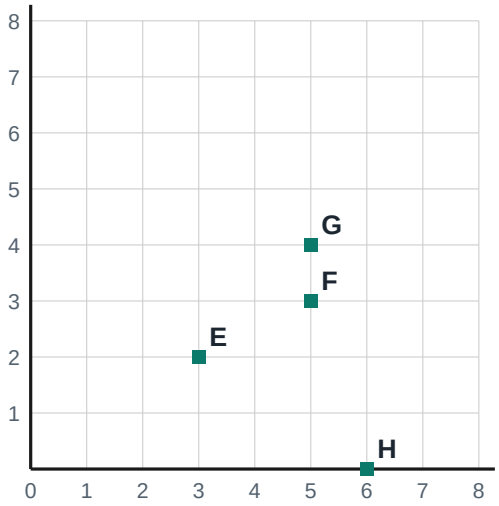

E(_____)
F(_____)
G(_____)
H(_____)

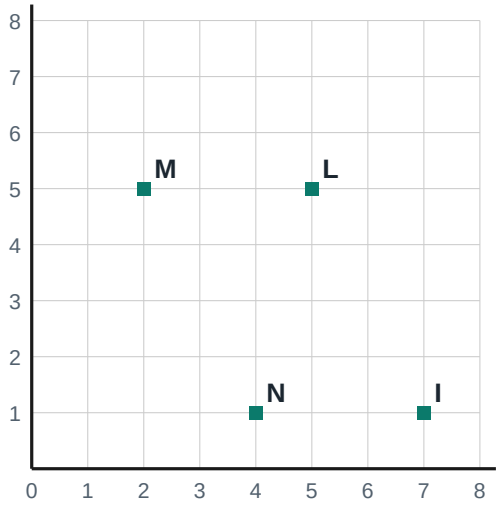

I(_____)
L(_____)
M(_____)
N(_____)

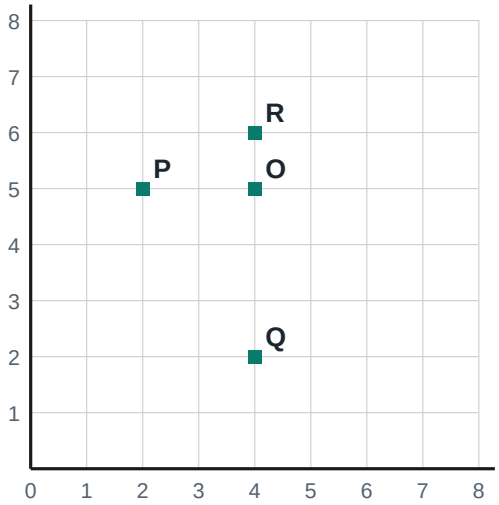

O(_____)
P(_____)
Q(_____)
R(_____)

Soluzioni: Coordinate dei punti

Le soluzioni di tutti gli esercizi della pagina 1.

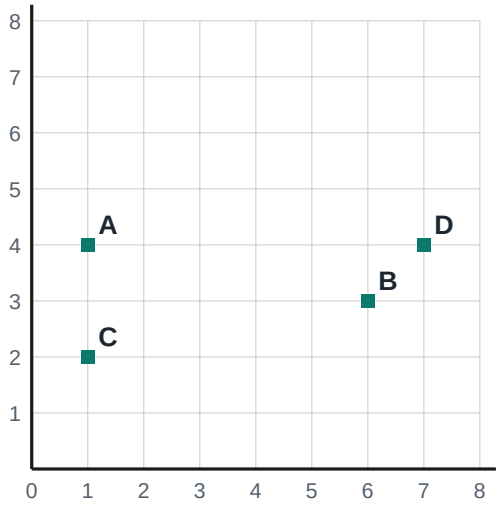

A(**1; 4**)
B(**6; 3**)
C(**1; 2**)
D(**7; 4**)

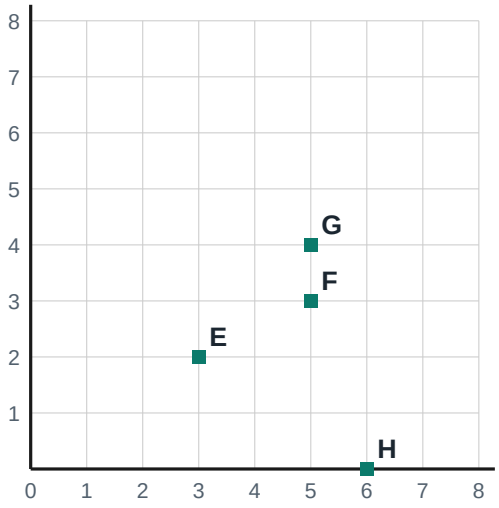

E(**3; 2**)
F(**5; 3**)
G(**5; 4**)
H(**6; 0**)

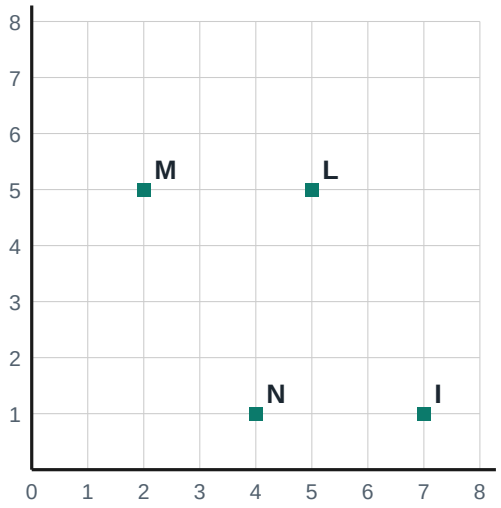

I(**7; 1**)
L(**5; 5**)
M(**2; 5**)
N(**4; 1**)

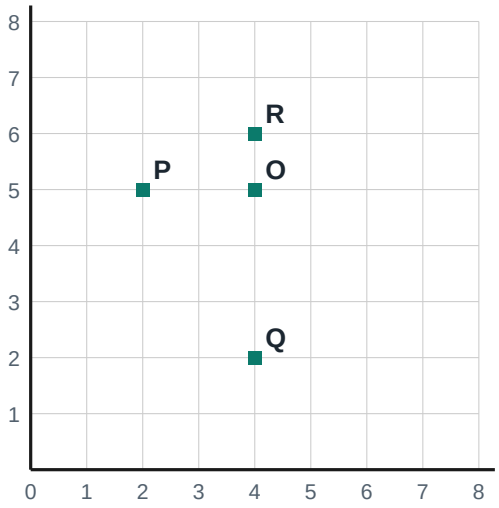

O(**4; 5**)
P(**2; 5**)
Q(**4; 2**)
R(**4; 6**)