Che frazione è colorata?

Conta le parti uguali (denominatore) e le parti colorate (numeratore), poi scrivi la frazione.

Nome: _____ Data: _____

1.  _____

2.  _____

3.  _____

4.  _____

5.  _____

6.  _____

7.  _____

8.  _____

9.  _____

10.  _____

11.  _____

12.  _____

Soluzioni: Frazioni colorate

Le soluzioni di tutti gli esercizi della pagina 1.

1.  **3/5**

2.  **1/3**

3.  **1/2**

4.  **3/8**

5.  **1/2**

6.  **1/2**

7.  **5/6**

8.  **1/2**

9. 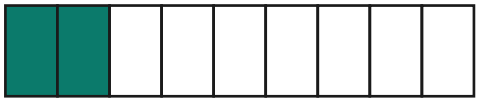 **2/9**

10.  **4/5**

11.  **1/2**

12.  **2/8**